The
MAYRON COLE PIANO METHOD

FUN SHEET

LONDON BRIDGE©



DO YOU KNOW?

1. This,  , is a _____.
(pedal mark or brace?)

2. This,  , is the _____-clef.
(G or F?)

Other names for this clef are the TREBLE CLEF and the HIGH CLEF. _____
(yes or no?)

3. This,  , is the _____-clef.
(G or F?)

Other names for this clef are the BASS CLEF and the LOW CLEF. _____
(yes or no?)

4. "*D.C. al Fine*" means go back to the _____ and play to "*Fine.*"
(2nd page or beginning?)

5. The TIME SIGNATURE is almost always written at the _____ of a composition.
(end or beginning?)

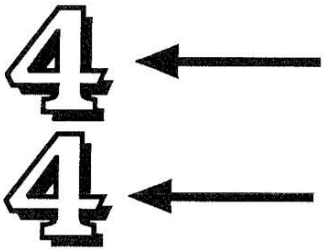

6. The TOP NUMBER of a TIME SIGNATURE tells you how many _____ are in each measure.
(notes or beats?)

7. The BOTTOM NUMBER of a TIME SIGNATURE tells you what type of note receives _____ beat(s).
(1 or 4?)

FREEPIANOMETHOD.COM
Although Mayron Cole owns the copyright to this page, she is granting permission to copy it **only** under the following condition: Teachers and students may print this page at home, school, or at their local print shop; and teachers and students may download, view, copy and/or share this page digitally.



LONDON BRIDGE

Folk Song

© Arr. by Mayron Cole

(orchestrated accompaniment has an 8 beat count-in)



F R E E P I A N O M E T H O D . C O M
Although Mayron Cole owns the copyright to this page, she is granting permission to copy it **only** under the following condition: Teachers and students may print this page at home, school, or at their local print shop; and teachers and students may download, view, copy and/or share this page digitally.



F R E E P I A N O M E T H O D . C O M
Although Mayron Cole owns the copyright to this page, she is granting permission to copy it **only** under the following condition: Teachers and students may print this page at home, school, or at their local print shop; and teachers and students may download, view, copy and/or share this page digitally.

DO YOU KNOW?

Place the correct letter from the second column on the blank beside its definition in the first column.

1. SHARP SIGN: _____. **A.** 

2. FLAT SIGN: _____. **B.** 

3. NATURAL SIGN: _____. **C.** 

4. TIME SIGNATURE: _____. **D.** 

5. HALF NOTE: _____. **E.** 

6. TWO-EIGHTHS: _____. **F.** 

7. DOTTED HALF NOTE: _____. **G.** 

8. WHOLE NOTE: _____. **H.** 

9. QUARTER NOTE: _____. **I.** 

10. DOUBLE BAR-LINES: _____. **J.** 
(Means, "The end.")



F R E E P I A N O M E T H O D . C O M
Although Mayron Cole owns the copyright to this page, she is granting permission to copy it **only** under the following condition: Teachers and students may print this page at home, school, or at their local print shop; and teachers and students may download, view, copy and/or share this page digitally.